ROUNDING WHOLE NUMBERS

3rd Grade



Printable & Google Slides


How to
WHOLE NUMBERS
d 525 to the nearest 10?
your place
next door
ater, add one more
let it rest
s in front stay the same
STOP
s behind, zero's their name!
DATE:
HOLE NUMBERS
rounding
Then, use the number line to help you
NAME:
ROUND
Directions: Cut out the
ten and place in the gu
30
32
28
25
34
27
How to
ROUND WHOLE NUMBERS
Can I round 525 to the nearest 10?
525
Find your place
525
Look next door
5 or greater, add one more
4 or less, let it rest
535
Numbers in front stay the same
STOP
530
Numbers behind, zero's their name!
264
Rounded to the nearest 100
300
6
336
Rounded to the nearest 10
340
Rounded to the nearest 100
300
30
Buccaneers
18
riors when rounded
eers when rounded
nd Lions together
nearest ten?
170 points
five games combined when
NAME:
ROUND
Directions: Cut out the
up or down when roun
Which cone ends up w
Rounds
102
34
62

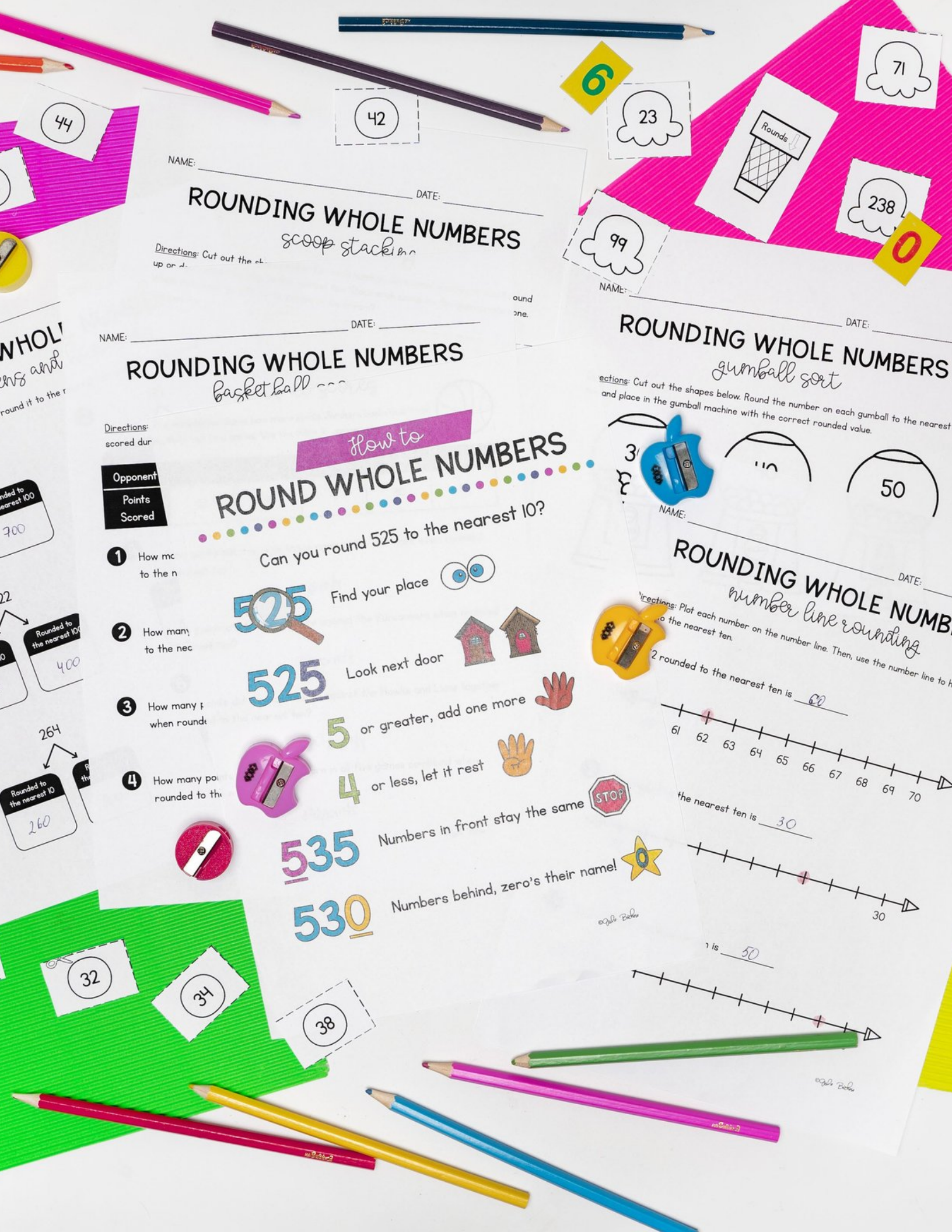

NAME:
DATE:
ROUNDING WHOLE NUMBERS
scoop stacking
Directions: Cut out the sh
up or d
NAME:
DATE:
ROUNDING WHOLE NUMBERS
basketball
Directions:
scored dur
Opponent
Points Scored
How to
ROUND WHOLE NUMBERS
Can you round 525 to the nearest 10?
525 Find your place
525 Look next door
5 or greater, add one more
4 or less, let it rest
535 Numbers in front stay the same
530 Numbers behind, zero's their name!
STOP
NAME:
DATE:
ROUNDING WHOLE NUMBERS
gumball sort
ections: Cut out the shapes below. Round the number on each gumball to the nearest
and place in the gumball machine with the correct rounded value.
50
NAME:
DATE:
ROUNDING WHOLE NUMB
number line rounding
irections: Plot each number on the number line. Then, use the number line to h
o the nearest ten.
2 rounded to the nearest ten is 60
61 62 63 64 65 66 67 68 69 70
the nearest ten is 30
30
is 50
Rounds
44
42
23
71
238
99
6
0
32
34
38
700
400
264
260


ROUNDING WHOLE NUMBERS
number line rounding
Directions: Drag the dot to plot each number on the number line. Then, use the number line to help you round to the nearest ten.
4 83 rounded to the nearest ten is
80
90
Drag me
ROUNDING WHOLE NUMBERS
scoop stacking
Directions: Cut out the shapes below. For each number, determine whether it would round up or down when rounding to the nearest ten. Stack each scoop on the appropriate cone.
Rounds
Rounds
DATE:
NAME:
ROUNDING WHOLE NUMBERS
basketball
ROUNDING WHOLE NUMBERS
and hundreds
145
264
25
34
36
30
32
41
28
27
525
525
5
4
535
530


ROUNDING WHOLE NUMBERS
nearest tens and hundreds
Directions: For each given number, round it to the nearest ten and nearest hundred.
1
658
Rounded to the nearest 10
Rounded to the nearest 100
2
145
Rounded to the nearest 10
Rounded to the nearest 100
DATE:
WHOLE NUMBERS
line rounding
DATE:
WHOLE NUMB
etball scores
UNDING WHOLE NUMB
gumball sort
Cut out the shapes below. Round the number on each gumball to the nearest
lace in the gumball machine with the correct rounded value.
NAME:
Directions: Cut
up or down wh
Which cone en
Rounds
ROUNDING
nearest
Directions: For each given
Rounded to the nearest
95
15
43
246
71
34
102
62
30
40
50
54
38
48
32
37
46
28
39
45
47
35
34
42
27
44
25
41
36


ROUNDING WHOLE NUMBERS
gumball sort
Directions: Cut out the shapes below. Round the number on each gumball to the nearest ten and place in the gumball machine with the correct rounded value.
30
40
50
41
43
44
45
47
48
DATE:
ROUNDING WHOLE NUMBERS
basketball scores
How to
ROUND WHOLE NUMBERS
Can you round 525 to the nearest 10?
Find your place
525
Look next door
5 or greater,
4 or less, let it r
535
Numbers in front
Numbers behind, zero's
Opponent
Hawks
Points Scored
23
How many points d
to the nearest ten
How many points
to the nearest t
NAME:
Directions: Cut out the shapes below. For each
up or down when rounding to the nearest ten.
Which cone ends up with more scoops of ice cr
Rounds
122
425
85
15
42
25
36
37
28
0
1
4
5
7


ROUNDING WHOLE NUMBERS
basketball scores
Directions: The table below shows how many points Jordan's basketball team scored during their last five games. Use the table to answer the questions.
Opponent | Hawks | Lions | Warriors | Rams | Buccaneers
Points Scored | 23 | 56 | 41 | 30 | 18
1 How many points did the team score against the Warriors when rounded to the nearest ten?
2 How many points did the team score against the Buccaneers when rounded to the nearest ten?
3 How many points did the team score against the Hawks and Lions together when rounded to the nearest ten?
4 How many points did the team score in all five games combined when rounded to the nearest ten?
How to
ROUND WHOLE NUMBERS
NAME:
DATE:
ROUNDING WHOLE NUMBERS
scoop stacking
Directions: Cut out the shapes below. For each number, determine whether it would round up or down when rounding to the nearest ten. Stack each scoop on the appropriate cone. Which cone ends up with more scoops of ice cream?
Rounds
NAME:
DATE:
NUMBERS
NUMBERS
DATE:
NAME:
ROUN
Directions: Cut out th
ten and place in the g
30
32
28
34
27
25
357
99
85
17
425
525
525
264



ROUNDING WHOLE NUMBERS

story problems

Directions: Solve the story problems.

1. Tamar has 76 buttons in her button collection. She gives away 10. About how many buttons does she have in her collection now when rounded to the nearest ten?





62

99

23

102

How to

ROUND WHOLE

Can you round 525 to th

525

Find your place (

NAME: _____

ROUND

Directions: The table below sh
scored during their last five ga

NAME: _____

ROUND

ROUNDING WHOLE NUMBERS

3rd grade

Table of Contents

1. Anchor Charts (2 pages)
2. Using Number Line for Rounding (8 pages)
3. Rounding to Tens and Hundreds (2 pages)
4. Rounding with Data Tables (4 pages)
5. Story Problems (4 pages)
6. Cut and Sort Activities (4 pages)
7. Rounding Games (9 pages)
8. Test Review (4 pages)
9. Test (4 pages)



Thank you for purchasing this MagiCore Learning digital resource!

The Google Slides version of this resource requires that you make a copy of the resource to your own Google Drive.

How to

ROUND WHOLE NUMBERS

Can you round 525 to the nearest 10?

525  Find your place 

525 Look next door 

5 or greater, add one more 

4 or less, let it rest 

535 Numbers in front stay the same 

530 Numbers behind, zero's their name! 

©Julie Bochese

NAME: _____ DATE: _____

ROUNDING WHOLE NUMBERS

number line rounding

Directions: Plot each number on the number line. Then, use the number line to help you round to the nearest ten.

1. 62 rounded to the nearest ten is _____

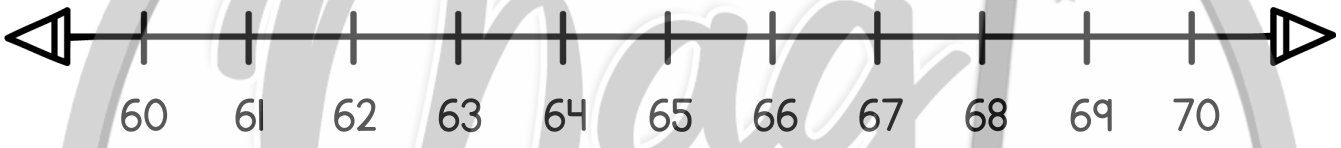

2. 27 rounded to the nearest ten is _____



3. 49 rounded to the nearest ten is _____

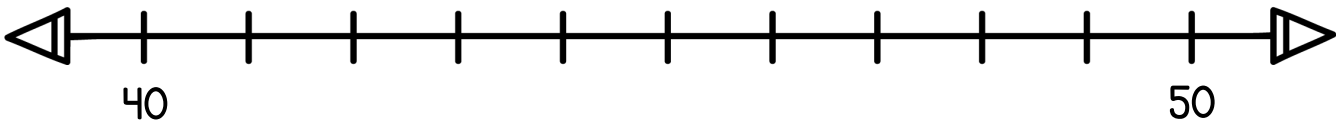

©Julie Bochese

NAME: _____ DATE: _____

ROUNDING WHOLE NUMBERS

nearest tens and hundreds

Directions: For each given number, round it to the nearest ten and nearest hundred.

1. 658

Rounded to the nearest 10	Rounded to the nearest 100

2. 145

Rounded to the nearest 10	Rounded to the nearest 100

3. 422

Rounded to the nearest 10	Rounded to the nearest 100

4. 580

Rounded to the nearest 10	Rounded to the nearest 100

5. 264

Rounded to the nearest 10	Rounded to the nearest 100

6. 336

Rounded to the nearest 10	Rounded to the nearest 100

©Julie Bochese

NAME: _____ DATE: _____

ROUNDING WHOLE NUMBERS

basketball scores



Directions: The table below shows how many points Jordan's basketball team scored during their last five games. Use the table to answer the questions.

Opponent	Hawks	Lions	Warriors	Rams	Buccaneers
Points Scored	23	56	41	30	18

1. How many points did the team score against the Warriors when rounded to the nearest ten?

2. How many points did the team score against the Buccaneers when rounded to the nearest ten?

3. How many points did the team score against the Hawks and Lions together when rounded to the nearest ten?

4. How many points did the team score in all five games combined when rounded to the nearest ten?

©Julie Bacheso

NAME: _____ DATE: _____

ROUNDING WHOLE NUMBERS

plenty of pages



Directions: The table below shows how many pages are in five different books from the library. Use the table to answer the questions.

Book Title	All About Aardvarks	Hot Air Balloons	Ice Cream Queen	Lost in the Jungle	Who Was John Adams?
Number of Pages	358	212	125	173	336

1. How many pages are in Ice Cream Queen when rounded to the nearest hundred?

2. How many pages are in All About Aardvarks when rounded to the nearest hundred?

3. How many pages are in Hot Air Balloons and Who Was John Adams? together when rounded to the nearest hundred?

4. How many pages are in all five books together when rounded to the nearest hundred?

©Julie Bacheso

NAME: _____ DATE: _____

ROUNDING WHOLE NUMBERS

piggy bank rounding

Directions: Cut out the shapes below. Round the number on each coin to the nearest hundred and place in the piggy bank with the correct rounded value.



125	341	178	215	137
286	220	96	312	109
162	239	250	332	72
113	184	205	328	222
174	145	280	150	266

©Jodi Bachus

NAME: _____ DATE: _____

ROUNDING WHOLE NUMBERS

rounding puzzle

Directions: Cut out the puzzle pieces below. Each puzzle will be made up of three pieces: an original number and that number rounded to the nearest ten and the nearest hundred. Assemble each puzzle.

EX



243

115

338

566

525

392

530

120

340

240

570

390

100

600

300

200

400

500

©Julie Bochorse

NAME: _____ DATE: _____

ROUNDING WHOLE NUMBERS

tens rounding round up

Directions:

1. Cut out the number cards.
2. Shuffle cards and place face down in a pile.
3. Each player picks one card. They place this card in the tens place on their answer sheet.
4. Each player then picks a second card. They place their card in the ones place on their answer sheet.
5. Players use the number lines to help them round their numbers to the nearest ten.
6. The player with the largest number when rounded wins a point. If there is a tie, all tied players win a point. Keep a tally of your points in on your answer sheet.
7. Players move their cards into the discard pile and repeat.
8. If cards run out, shuffle cards from discard pile and replace face down in center pile.
9. The player with the most points after all rounds wins.

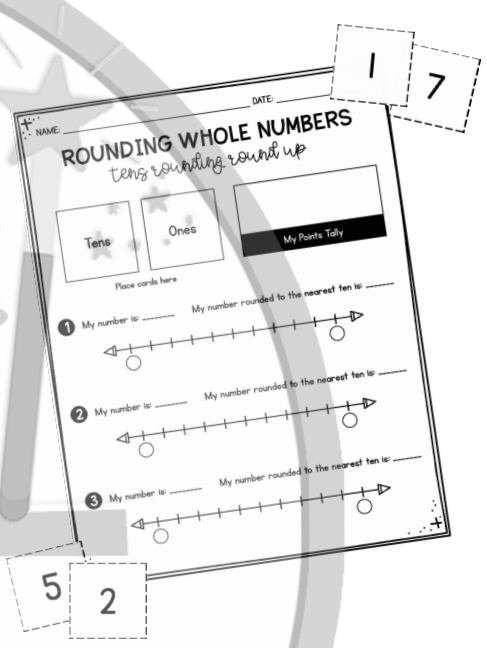



©Julie Bochese

NAME: _____ DATE: _____

ROUNDING WHOLE NUMBERS

tens rounding round up

Tens	Ones	My Points Tally
Place cards here		

1. My number is: _____ My number rounded to the nearest ten is: _____



2. My number is: _____ My number rounded to the nearest ten is: _____



3. My number is: _____ My number rounded to the nearest ten is: _____

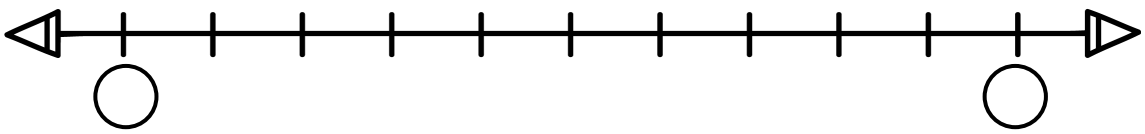

©Julie Bochese

NAME: _____ DATE: _____

ROUNDING WHOLE NUMBERS

test review

Directions: Use the number line to round each number to the nearest ten or hundred.

1. 84 rounded to the nearest ten is _____



2. 36 rounded to the nearest ten is _____



3. 247 rounded to the nearest hundred is _____

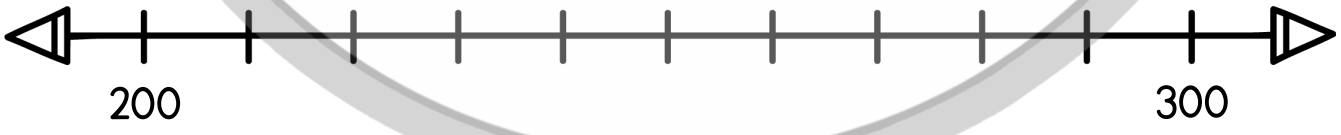

4. 152 rounded to the nearest hundred is _____

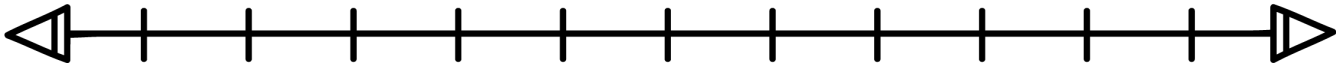

©Julie Bacheso

Terms of Use

How Can I Use This Resource?

Thank you for trusting MagiCore. Our mission is to create resources that support teachers and promote student success. Please note that this resource is licensed for use by a single teacher in a classroom setting. If you need to use this resource with more than one teacher and/or across multiple classrooms, additional licenses are available at a discount. You can purchase additional licenses by visiting your TPT "Purchases" page and then selecting "Download Additional Licenses" or by contacting me at julie@magicorelearning.com.



Good to Go

- Use this resource personally or with your own children.
- Use this resource in your own classroom with your students.
- Provide this resource to your students to use at your instruction.
- Print and/or copy for use in your own classroom.
- Provide printed pages to a substitute teacher with the sole purpose of instructing your students.
- Share with your students via a secure document portal or electronic learning platform that requires individual user verification and limits access to only the students in your own classroom (e.g. Google Classroom).
- Review this resource with others with the sole purpose of recommending it to others for purchase, provided you share one of the links below:

https://magicorelearning.com/

https://www.teacherspayteachers.com/Store/Magicore



Not O.K.

- Share with others to use personally.
- Share with others to use in another classroom.
- Print or copy any page(s) and distribute them to other teachers or other classrooms.
- Publish or host online in a manner where any of the material is accessible to anyone who is not a student in your own classroom., including but not limited to personal, classroom, or district websites that are accessible to the general public.
- Use this resource commercially (e.g. Outschool).
- Publish, sell, or otherwise distribute this product to anyone in manner inconsistent with these terms of use.

© Copyright 2020, 2022. All rights reserved. The unlicensed reproduction or distribution of this product is strictly prohibited. Permission is granted to the original purchaser or licensee to make copies to use with students and/or to assign to students digitally providing it is only available to students assigned directly to the purchaser. Using this product in any manner that makes it accessible to the general public is strictly forbidden. Commercial use, including but not limited to online or in person classes, is prohibited. Contact julie@magicorelearning.com for commercial licensing information. Sharing without permission or hosting online in a public manner is a violation of the Digital Millennium Copyright Act (DMCA). These terms may be updated at any time. You can see the most up to date Terms of Use at https://magicorelearning.com/terms-of-use.

Let's Connect!

www.magicorelearning.com

https://www.teacherspayteachers.com/Store/Magicore

https://www.facebook.com/MagiCoreLearning/

https://www.instagram.com/magicorelearning/

https://www.pinterest.com/magicorelearning/pins/

Julie@magicorelearning.com

Looking for more?

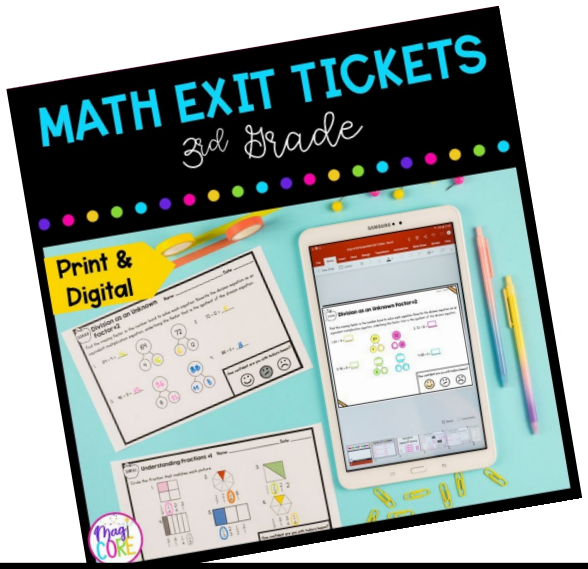



Membership Opportunity!

If you love these resources and want access to more, check out my membership opportunity with the MagiCore Club.

[Join my MagiCore Club waitlist!]

MagiCore Club opens its membership doors twice a year to offer teachers all of the resources you love, with a membership discount. You can also find support through my custom learning plan.

Find out more: https://magicorelearning.com/membership



CREDITS